Cambridge Assessment International Education

Cambridge O Level

CANDIDATE NAME	

CENTRE NUMBER						CANDIDATE NUMBER				

1361753870

MATHEMATICS (SYLLABUS D) **4024/12**

Paper 1 **October/November 2023**

2 hours

You must answer on the question paper.

You will need: Geometrical instruments

INSTRUCTIONS

- Answer **all** questions.
- Use a black or dark blue pen. You may use an HB pencil for any diagrams or graphs.
- Write your name, centre number and candidate number in the boxes at the top of the page.
- Write your answer to each question in the space provided.
- Do **not** use an erasable pen or correction fluid.
- Do **not** write on any bar codes.
- Calculators must **not** be used in this paper.
- You may use tracing paper.
- You must show all necessary working clearly.

INFORMATION

- The total mark for this paper is 80.
- The number of marks for each question or part question is shown in brackets [ ].

This document has **16** pages.

DC (LK/CGW) 317579/3
© UCLES 2023

ELECTRONIC CALCULATORS MUST NOT BE USED IN THIS PAPER

1 Work out.

(a) 0.05×0.3

..... [1]

(b) $600 \div 0.2$

..... [1]

(c) $20 - 12 \div (8 - 6)$

..... [1]

2

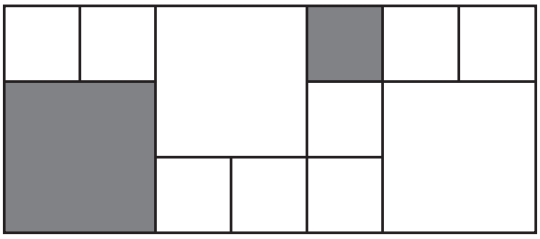

This rectangle is split into squares of two different sizes.

Find the fraction of the rectangle that is shaded grey.

..... [1]

© UCLES 2023

3 **(a)** Find the decimal which is exactly halfway between $\frac{3}{5}$ and 68% .

..... [1]

(b) Write 4.073 82 correct to 3 decimal places.

..... [1]

(c) Evaluate $\sqrt[3]{64}$.

..... [1]

4 Sonu records the temperature, in °C, at midnight every day for 12 days.
Here are the results in order, starting with the coldest.

$-6 \quad -5 \quad -3 \quad -2 \quad -1 \quad -1 \quad T \quad 5 \quad 5 \quad 6 \quad 6 \quad 7$

(a) Find the range of the temperatures.

..... °C [1]

(b) The median temperature is 1 °C.

Find the value of T.

$T =$ ..... [1]

5 Anna and Ria share some money in the ratio 5 : 9.
Ria receives \$8 more than Anna.

Work out the total amount of money that is shared.

\$ ..... [2]

6

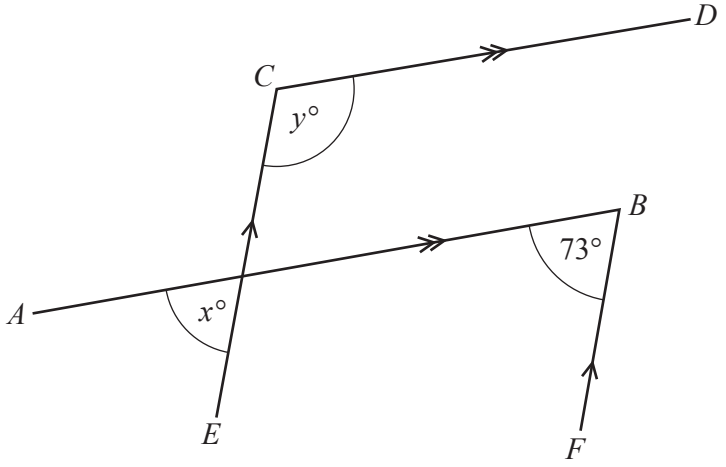

NOT TO SCALE

AB and *CD* are parallel lines.
EC and *FB* are parallel lines.
Angle *ABF* = 73°.

(a) Find the value of *x*.

x = ... [1]

(b) Find the value of *y*.

y = ... [1]

7 Shape A and triangles P and Q are drawn on a centimetre square grid.

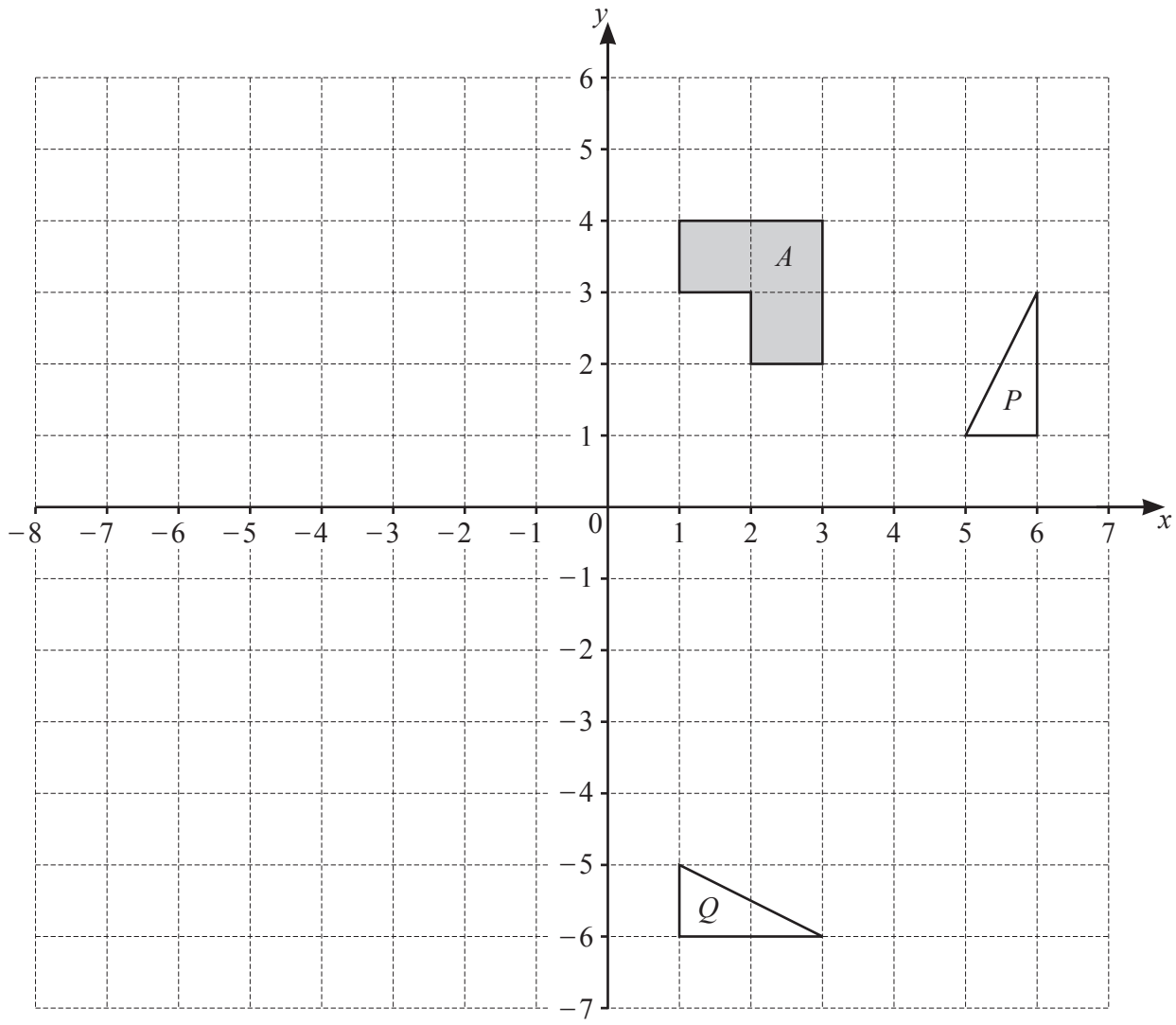

(a) Describe fully the **single** transformation that maps triangle P onto triangle Q.

.....

..... [3]

(b) Shape B is an enlargement of shape A.
The centre of enlargement is (5, 5).
The area of shape B is $27\,\text{cm}^2$.

Draw shape B on the grid.

[3]

8 **(a)** Write the number $0.004\,93$ in standard form.

..... [1]

(b) Evaluate $(4 \times 10^9) \times (2 \times 10^{-2})$.
Give your answer in standard form.

..... [1]

9 **(a)** Write 180 as the product of its prime factors.

..... [2]

(b) Expressed as the product of their prime factors,

$$36 = 2^2 \times 3^2 \qquad \text{and} \qquad N = 2^2 \times 3 \times k, \quad \text{where } k > 3.$$

180 is the lowest common multiple (LCM) of 36 and N.

Find the value of k.

$k =$ ..... [1]

10 By writing each number correct to 1 significant figure, estimate the value of

$$\sqrt{\frac{1240 \times 3.8}{11.2}}.$$

..... [2]

11 Solve $7m - 13 \leqslant 8$.

..... [2]

12 Solve the simultaneous equations.
Show all your working.

$$5x + 4y = 14$$
$$3x - 2y = 15$$

$x =$ .....

$y =$ ..... [3]

13 A list of eight numbers has a mean of 12.
The first five numbers have a mean of 9.

Find the sum of the three remaining numbers.

..... [2]

14

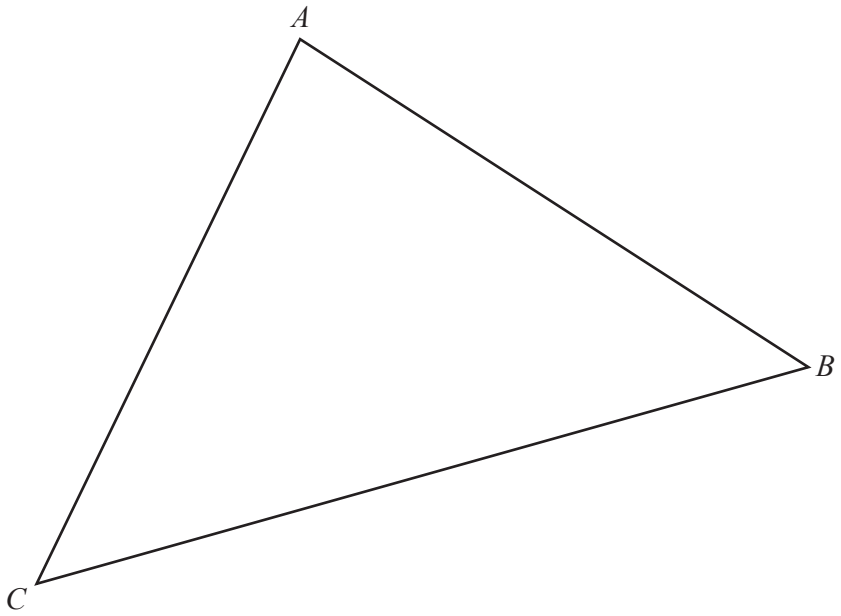

(a) Measure angle *ABC*.

Angle *ABC* = ... [1]

(b) **Using compasses and a straight edge only**, construct the perpendicular bisector of *AC*. [2]

(c) On the diagram, shade the region inside triangle *ABC* that is

- nearer to *A* than to *C*

and

- more than 6 cm from *B*. [2]

15 **(a)** The second term of a linear sequence is 28.
The fifth term of the sequence is 16.

Find the first term, the third term and the fourth term of this sequence.

First term = ...

Third term = ...

Fourth term = ... [2]

(b) These are the first five terms of a different sequence.

3 9 19 33 51

Find an expression for the nth term of this sequence.

..... [2]

16 $T = \sqrt{P - 4}$

(a) Work out the value of T when $P = 40$.

$T =$ ..... [1]

(b) Rearrange the formula to make P the subject.

$P =$ ..... [2]

17 The heights of 80 plants are measured.
The table shows the results.

Height (h centimetres)	$h \leqslant 2$	$h \leqslant 4$	$h \leqslant 6$	$h \leqslant 8$	$h \leqslant 10$	$h \leqslant 12$
Cumulative frequency	4	18	42	60	72	80

(a) Draw a cumulative frequency diagram to show this information.

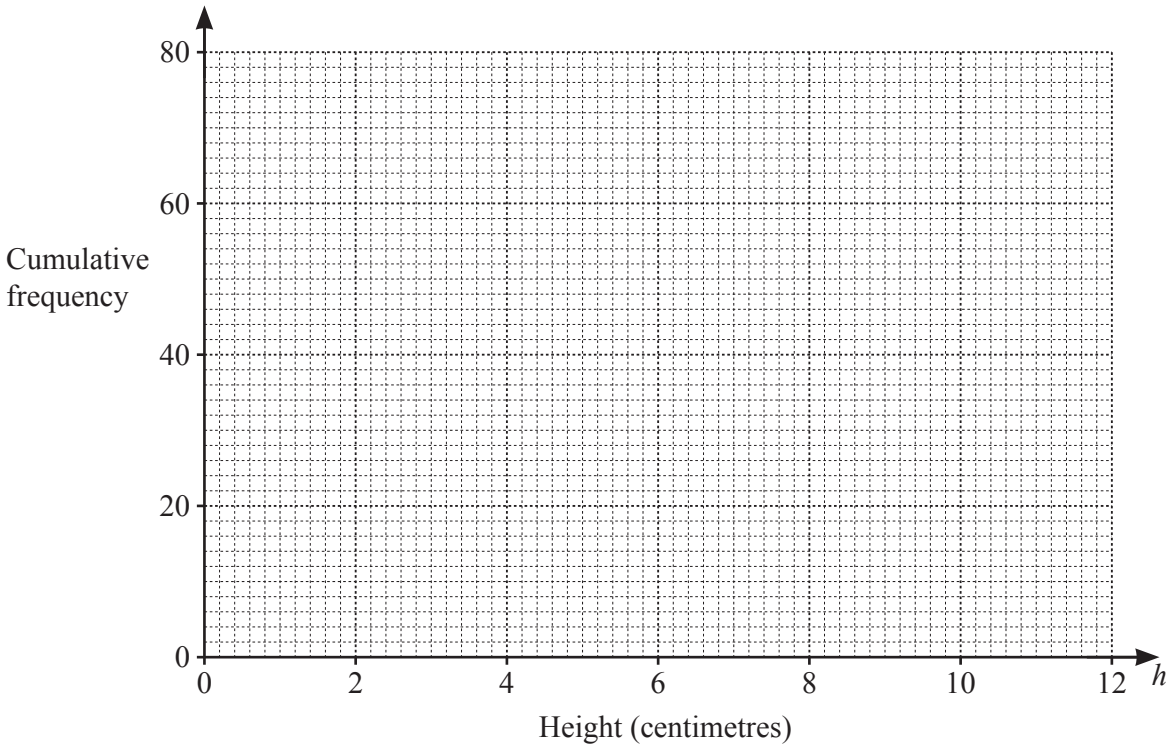

[2]

(b) Use your diagram to find an estimate for the interquartile range.

..... cm [2]

(c) Plants are sold when they are taller than H centimetres.
28 of these plants are sold.

Find the value of H.

$H =$ ..... [2]

18 The diagram shows the speed–time graph of part of a journey for two cyclists, *A* and *B*.

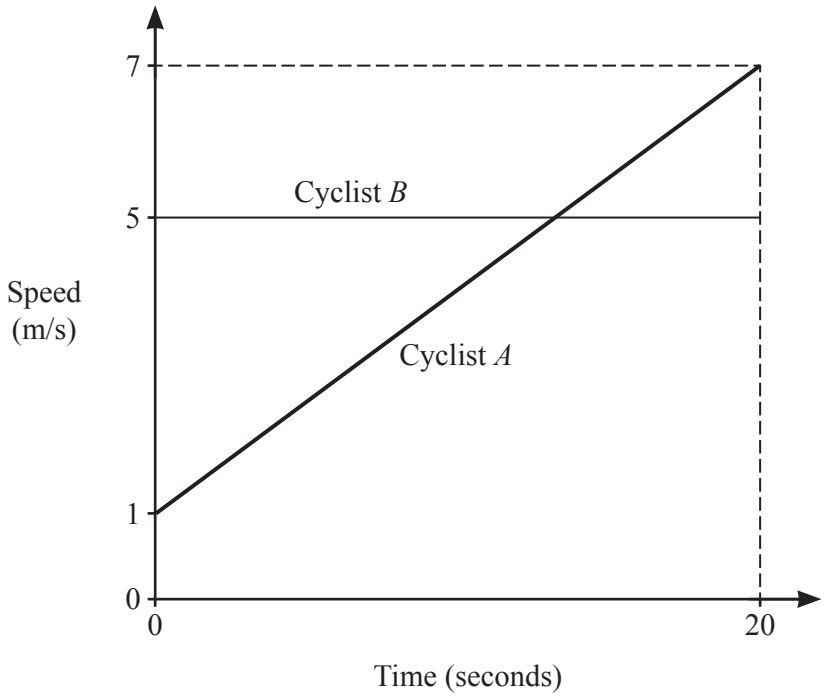

NOT TO SCALE

(a) Find the acceleration of cyclist *A* during the first 20 seconds.

..... m/s^2 [1]

(b) Find which cyclist travelled further in the first 20 seconds and by how many metres.

Cyclist ..... travelled further by ..... metres [3]

19 Express as a single fraction in its simplest form.

$$\frac{x+1}{8}+\frac{3x}{4}-\frac{5x}{16}$$

..... [2]

20 Factorise.

(a) $2cd+ce-6d-3e$

..... [2]

(b) $3v^2-27t^2$

..... [2]

© UCLES 2023

21

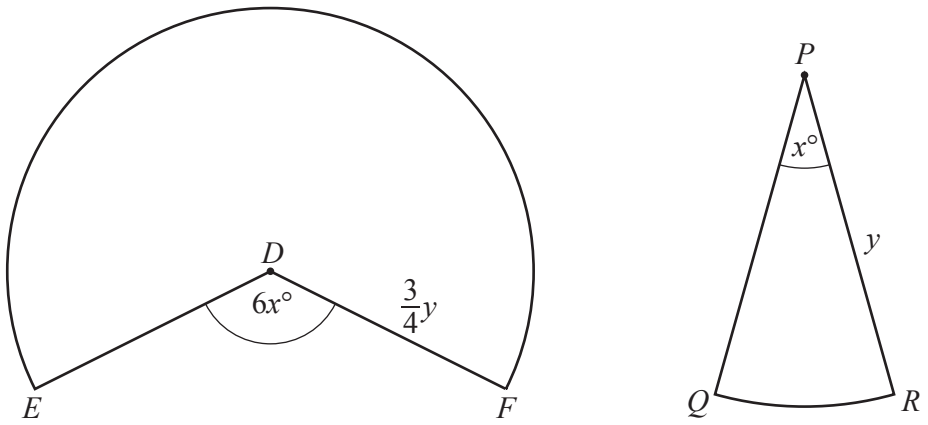

Diagram *A* Diagram *B*

NOT TO SCALE

Diagram *A* shows a sector of a circle, centre *D* and radius $\frac{3}{4}y$ cm.
The obtuse angle $EDF = 6x°$.

Diagram *B* shows a sector of a circle, centre *P* and radius y cm.
The sector angle is $x°$.

(a) The length of the major arc *EF* is 9 times the length of the arc *QR*.

Show that $x = 20$.

[3]

(b) Find the value of y when the area of sector *QPR* is equal to $2\pi\,\text{cm}^2$.

$y =$ ..... [2]

22

$$\begin{pmatrix} x & 3 \\ 2 & x+1 \end{pmatrix}\begin{pmatrix} x-1 \\ 2 \end{pmatrix} = \begin{pmatrix} 2x+6 \\ y \end{pmatrix}$$

(a) Show that $x^2 - 3x = 0$.

[2]

(b) **(i)** Solve $x^2 - 3x = 0$.

$x =$ ..... or $x =$ ..... [2]

(ii) Find the value of y when $x > 0$.

$y =$ ..... [2]

23 A shop sells hats (H), scarves (S) and gloves (G).
A group of 40 people are asked which items they buy in the shop.
Some of the results are shown in the Venn diagram.

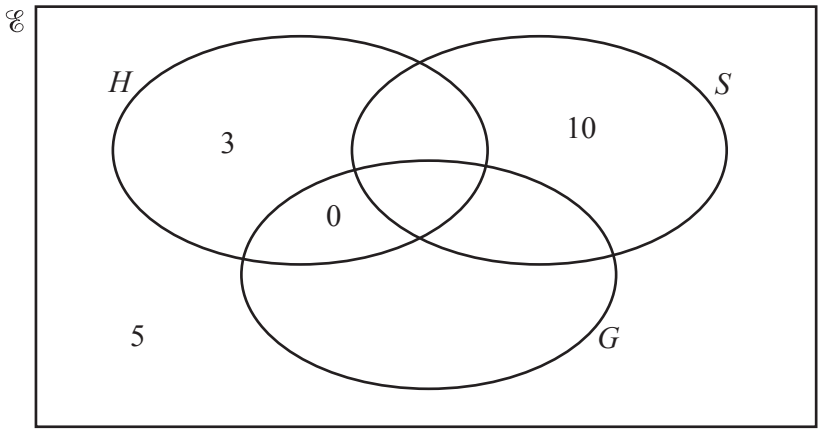

(a) 2 people buy all three items.
Those people that buy both a hat and a scarf also buy gloves.
4 people buy exactly two items.

Use this information to complete the Venn diagram.

[2]

(b) Work out $n(S \cap (H \cup G)')$.

..... [1]

Question 24 is printed on the next page.

24

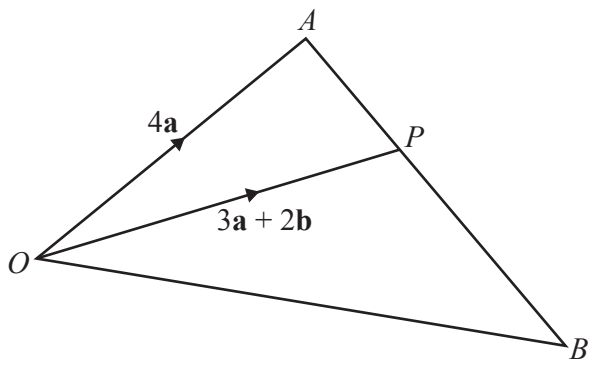

NOT TO SCALE

OAB is a triangle.
P lies on AB and $AP : PB = 2 : 3$.
$\overrightarrow{OA} = 4\mathbf{a}$ and $\overrightarrow{OP} = 3\mathbf{a} + 2\mathbf{b}$.

(a) Find, in terms of **a** and **b**, giving your answer in its simplest form

(i) $\overrightarrow{AP}$

$\overrightarrow{AP} =$ ..... [1]

(ii) $\overrightarrow{OB}$.

$\overrightarrow{OB} =$ ..... [3]

(b) Q is a point on OA such that $\overrightarrow{QP}$ is parallel to $\overrightarrow{OB}$.

Find $\overrightarrow{QP}$.

$\overrightarrow{QP} =$ ..... [1]

Permission to reproduce items where third-party owned material protected by copyright is included has been sought and cleared where possible. Every reasonable effort has been made by the publisher (UCLES) to trace copyright holders, but if any items requiring clearance have unwittingly been included, the publisher will be pleased to make amends at the earliest possible opportunity.

To avoid the issue of disclosure of answer-related information to candidates, all copyright acknowledgements are reproduced online in the Cambridge Assessment International Education Copyright Acknowledgements Booklet. This is produced for each series of examinations and is freely available to download at www.cambridgeinternational.org after the live examination series.

Cambridge Assessment International Education is part of Cambridge Assessment. Cambridge Assessment is the brand name of the University of Cambridge Local Examinations Syndicate (UCLES), which is a department of the University of Cambridge.

© UCLES 2023