Cambridge Assessment International Education

Cambridge O Level

CANDIDATE NAME	

CENTRE NUMBER						CANDIDATE NUMBER				

1802389966

ADDITIONAL MATHEMATICS **4037/12**

Paper 1 **May/June 2020**

2 hours

You must answer on the question paper.

No additional materials are needed.

INSTRUCTIONS

- Answer **all** questions.
- Use a black or dark blue pen. You may use an HB pencil for any diagrams or graphs.
- Write your name, centre number and candidate number in the boxes at the top of the page.
- Write your answer to each question in the space provided.
- Do **not** use an erasable pen or correction fluid.
- Do **not** write on any bar codes.
- You should use a calculator where appropriate.
- You must show all necessary working clearly; no marks will be given for unsupported answers from a calculator.
- Give non-exact numerical answers correct to 3 significant figures, or 1 decimal place for angles in degrees, unless a different level of accuracy is specified in the question.

INFORMATION

- The total mark for this paper is 80.
- The number of marks for each question or part question is shown in brackets [ ].

This document has **16** pages. Blank pages are indicated.

DC (DH) 196729/1 **R**
© UCLES 2020

[Turn over

Mathematical Formulae

1. ALGEBRA

Quadratic Equation

For the equation $ax^2 + bx + c = 0$,

$$x = \frac{-b \pm \sqrt{b^2 - 4ac}}{2a}$$

Binomial Theorem

$$(a+b)^n = a^n + \binom{n}{1}a^{n-1}b + \binom{n}{2}a^{n-2}b^2 + \ldots + \binom{n}{r}a^{n-r}b^r + \ldots + b^n$$

where n is a positive integer and $\binom{n}{r} = \frac{n!}{(n-r)!r!}$

Arithmetic series $\quad u_n = a + (n-1)d$

$$S_n = \frac{1}{2}n(a+l) = \frac{1}{2}n\{2a + (n-1)d\}$$

Geometric series $\quad u_n = ar^{n-1}$

$$S_n = \frac{a(1-r^n)}{1-r} \quad (r \neq 1)$$

$$S_\infty = \frac{a}{1-r} \quad (|r| < 1)$$

2. TRIGONOMETRY

Identities

$$\sin^2 A + \cos^2 A = 1$$
$$\sec^2 A = 1 + \tan^2 A$$
$$\operatorname{cosec}^2 A = 1 + \cot^2 A$$

Formulae for ΔABC

$$\frac{a}{\sin A} = \frac{b}{\sin B} = \frac{c}{\sin C}$$

$$a^2 = b^2 + c^2 - 2bc \cos A$$

$$\Delta = \frac{1}{2}bc \sin A$$

© UCLES 2020

1 On the axes below, sketch the graph of $y = |(x-2)(x+1)(x+2)|$ showing the coordinates of the points where the curve meets the axes. [3]

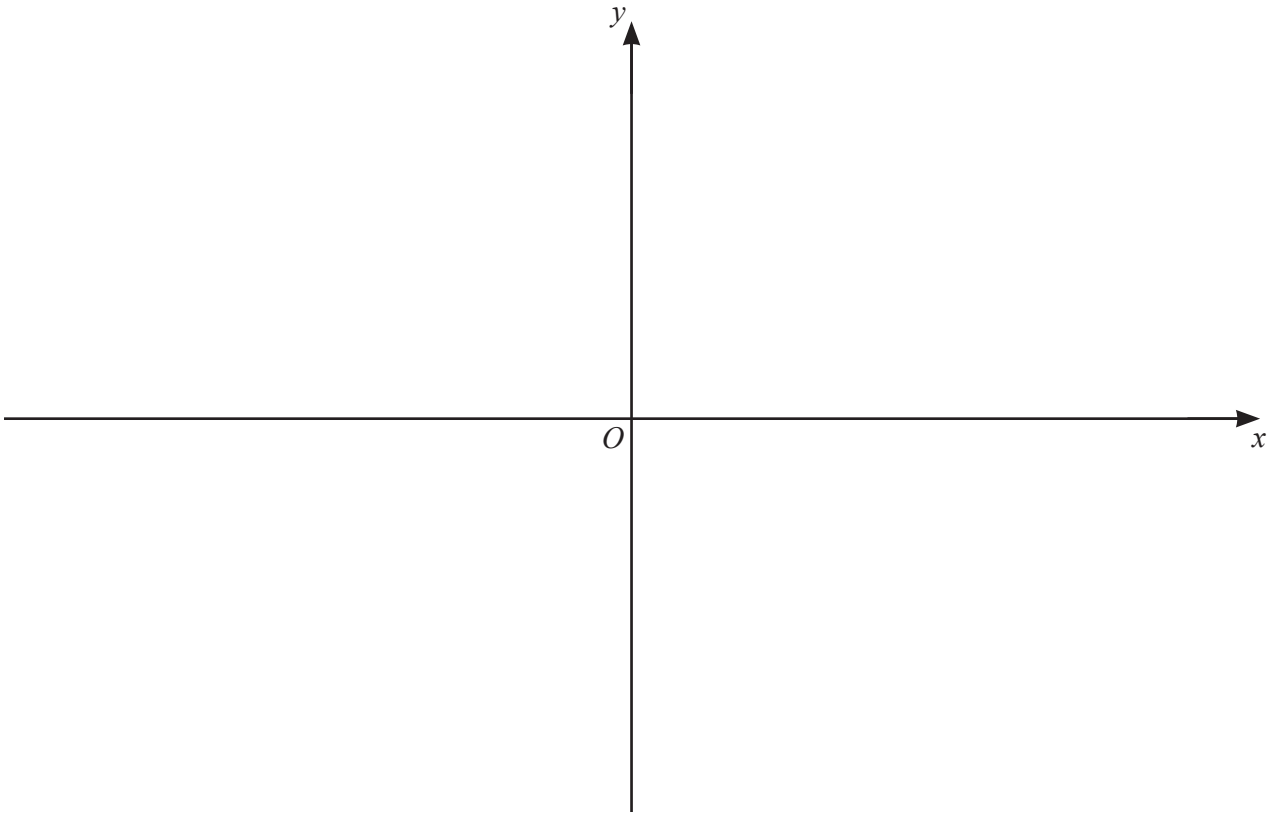

2 The volume, V, of a sphere of radius r is given by $V = \frac{4}{3}\pi r^3$.

The radius, r cm, of a sphere is increasing at the rate of $0.5\,\text{cms}^{-1}$. Find, in terms of π, the rate of change of the volume of the sphere when $r = 0.25$. [4]

3 **(a)** Find the first 3 terms in the expansion of $\left(4-\frac{x}{16}\right)^6$ in ascending powers of x. Give each term in its simplest form. [3]

(b) Hence find the term independent of x in the expansion of $\left(4-\frac{x}{16}\right)^6\left(x-\frac{1}{x}\right)^2$. [3]

4 **(a)** **(i)** Find how many different 5-digit numbers can be formed using the digits 1, 2, 3, 5, 7 and 8, if each digit may be used only once in any number. [1]

(ii) How many of the numbers found in **part (i)** are not divisible by 5? [1]

(iii) How many of the numbers found in **part (i)** are even and greater than 30 000? [4]

(b) The number of combinations of n items taken 3 at a time is 6 times the number of combinations of n items taken 2 at a time. Find the value of the constant n. [4]

© UCLES 2020

5 $\mathrm{f} : x \mapsto (2x+3)^2 \quad \text{for } x > 0$

(a) Find the range of f. [1]

(b) Explain why f has an inverse. [1]

(c) Find f^{-1}. [3]

(d) State the domain of f^{-1}. [1]

(e) Given that $\mathrm{g} : x \mapsto \ln(x+4)$ for $x > 0$, find the exact solution of $\mathrm{fg}(x) = 49$. [3]

6

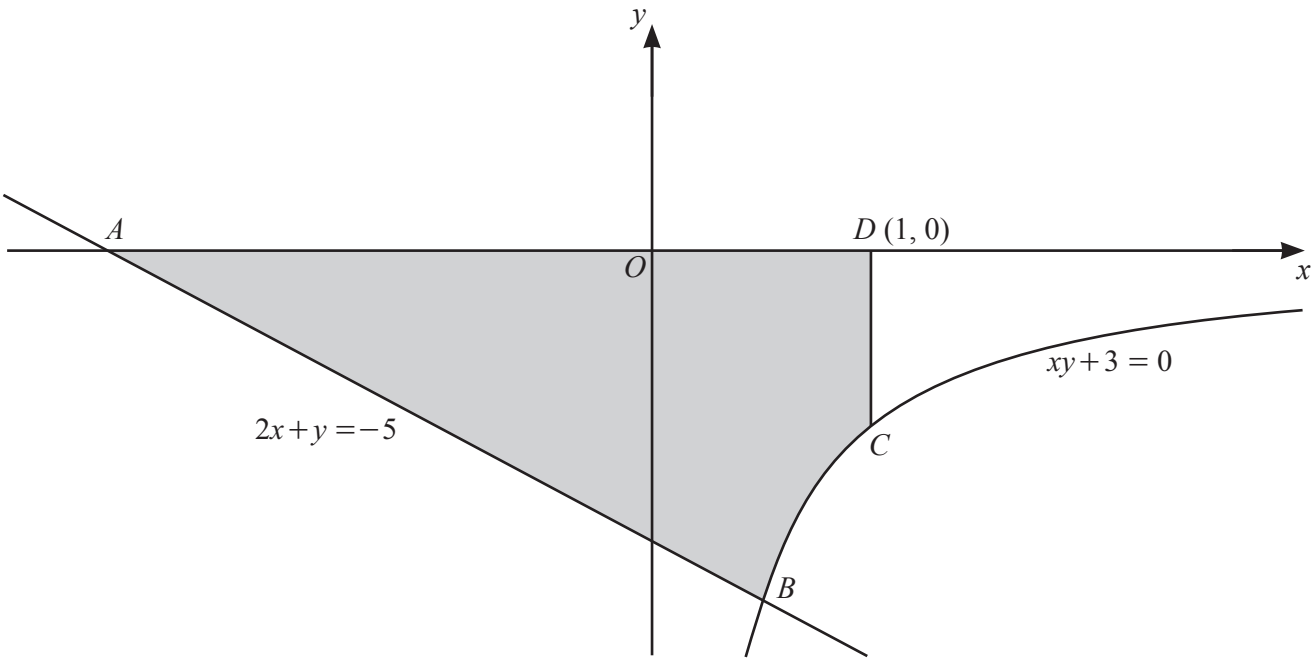

The diagram shows the straight line $2x + y = -5$ and part of the curve $xy + 3 = 0$. The straight line intersects the x-axis at the point A and intersects the curve at the point B. The point C lies on the curve. The point D has coordinates $(1, 0)$. The line CD is parallel to the y-axis.

(a) Find the coordinates of each of the points A and B. [3]

(b) Find the area of the shaded region, giving your answer in the form $p + \ln q$, where p and q are positive integers. [6]

7 **(a)** Given that $y = \left(x^2 - 1\right)\sqrt{5x+2}$, show that $\frac{\mathrm{d}y}{\mathrm{d}x} = \frac{Ax^2 + Bx + C}{2\sqrt{5x+2}}$, where A, B and C are integers. [5]

(b) Find the coordinates of the stationary point of the curve $y = \left(x^2 - 1\right)\sqrt{5x+2}$, for $x > 0$. Give each coordinate correct to 2 significant figures. [3]

(c) Determine the nature of this stationary point. [2]

8

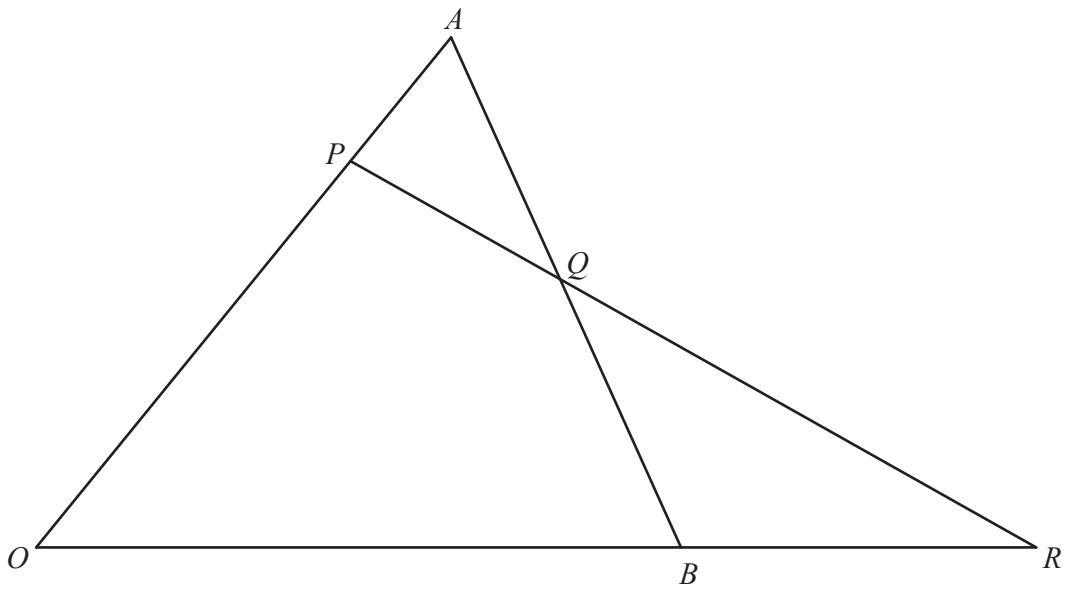

The diagram shows a triangle OAB such that $\overrightarrow{OA} = \mathbf{a}$ and $\overrightarrow{OB} = \mathbf{b}$. The point P lies on OA such that $OP = \frac{3}{4}OA$. The point Q is the mid-point of AB. The lines OB and PQ are extended to meet at the point R. Find, in terms of **a** and **b**,

(a) $\overrightarrow{AB}$, [1]

(b) $\overrightarrow{PQ}$. Give your answer in its simplest form. [3]

It is given that $n\overrightarrow{PQ} = \overrightarrow{QR}$ and $\overrightarrow{BR} = k\mathbf{b}$, where n and k are positive constants.

(c) Find $\overrightarrow{QR}$ in terms of n, **a** and **b**. [1]

(d) Find $\overrightarrow{QR}$ in terms of k, **a** and **b**. [2]

(e) Hence find the value of n and of k. [3]

9 **(a)** A particle P moves in a straight line such that its displacement, x m, from a fixed point O at time t s is given by $x = 10\sin 2t - 5$.

(i) Find the speed of P when $t = \pi$. [1]

(ii) Find the value of t for which P is first at rest. [2]

(iii) Find the acceleration of P when it is first at rest. [2]

(b)

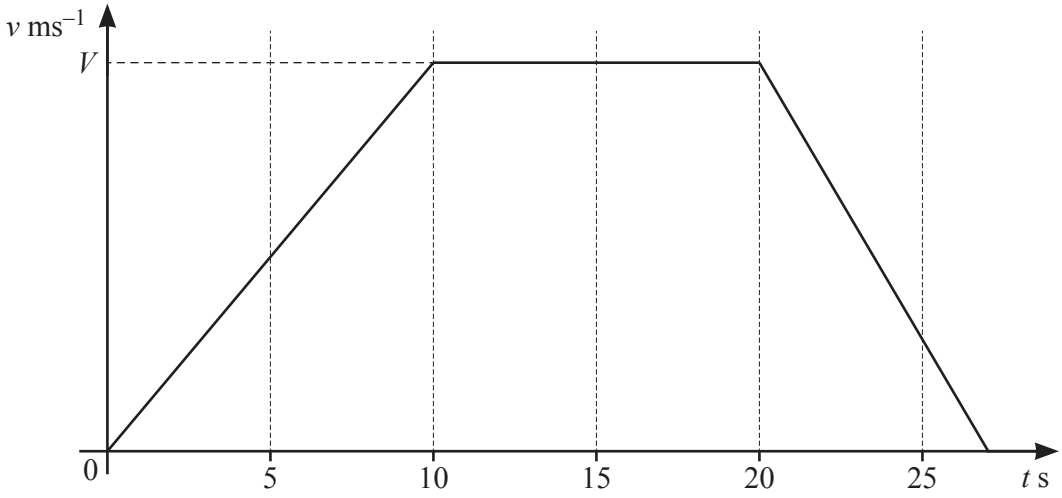

The diagram shows the velocity–time graph for a particle Q travelling in a straight line with velocity $v\,\text{ms}^{-1}$ at time t s. The particle accelerates at $3.5\,\text{ms}^{-2}$ for the first 10 s of its motion and then travels at constant velocity, $V\,\text{ms}^{-1}$, for 10 s. The particle then decelerates at a constant rate and comes to rest. The distance travelled during the interval $20 \leqslant t \leqslant 25$ is 112.5 m.

(i) Find the value of V. [1]

(ii) Find the velocity of Q when $t = 25$. [3]

(iii) Find the value of t when Q comes to rest. [3]

Question 10 is printed on the next page.

10 **(a)** Solve $\tan 3x = -1$ for $-\frac{\pi}{2} \leqslant x \leqslant \frac{\pi}{2}$ radians, giving your answers in terms of π. [4]

(b) Use your answers to **part (a)** to sketch the graph of $y = 4\tan 3x + 4$ for $-\frac{\pi}{2} \leqslant x \leqslant \frac{\pi}{2}$ radians on the axes below. Show the coordinates of the points where the curve meets the axes.

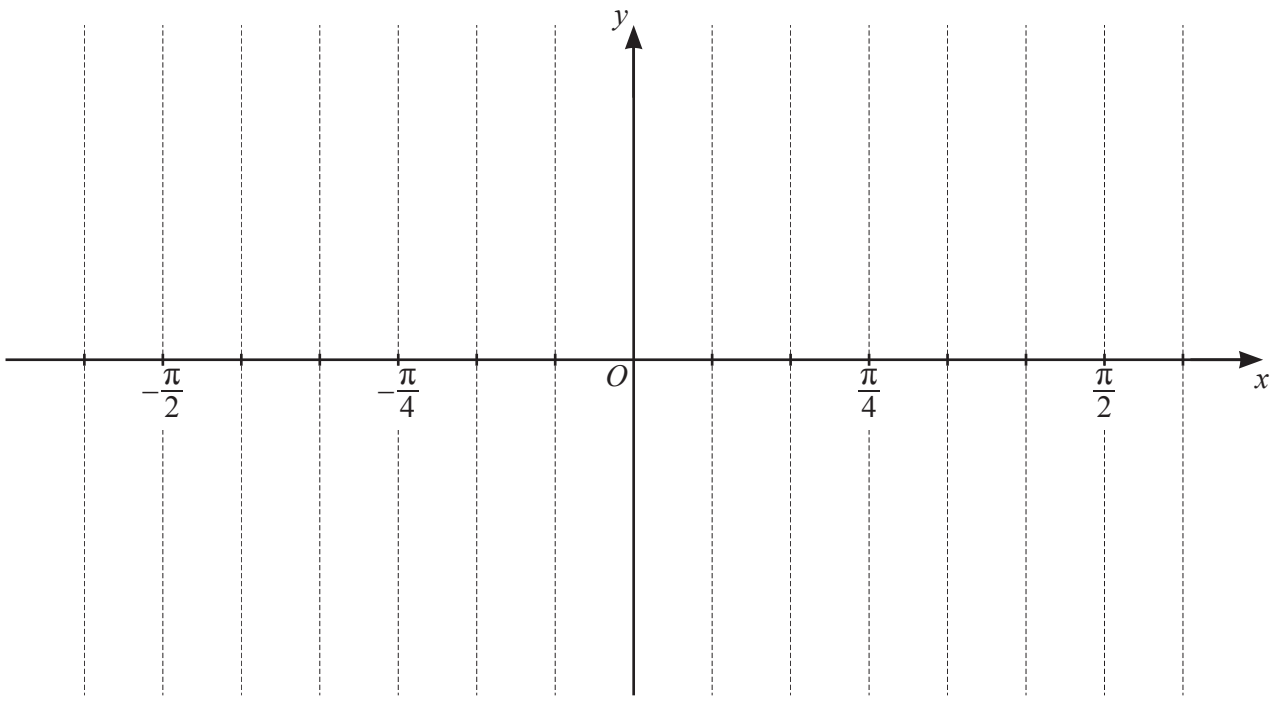

[3]

Permission to reproduce items where third-party owned material protected by copyright is included has been sought and cleared where possible. Every reasonable effort has been made by the publisher (UCLES) to trace copyright holders, but if any items requiring clearance have unwittingly been included, the publisher will be pleased to make amends at the earliest possible opportunity.

To avoid the issue of disclosure of answer-related information to candidates, all copyright acknowledgements are reproduced online in the Cambridge Assessment International Education Copyright Acknowledgements Booklet. This is produced for each series of examinations and is freely available to download at www.cambridgeinternational.org after the live examination series.

Cambridge Assessment International Education is part of the Cambridge Assessment Group. Cambridge Assessment is the brand name of the University of Cambridge Local Examinations Syndicate (UCLES), which itself is a department of the University of Cambridge.

© UCLES 2020